3 IDEA DE VOLUMEN

1. ¿Cuántos cubitos caben dentro de cada caja?

a)

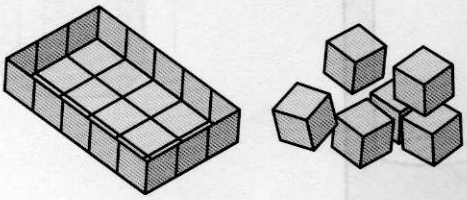

b)

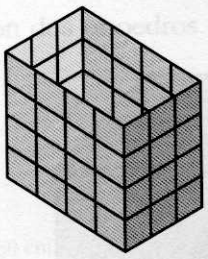

2. ¿Cuántos cubitos forman cada construcción? Si los cubitos tienen 1 cm de arista, ¿cuál es el volumen, en centímetros cúbicos, de cada construcción?

a)



b)



c)

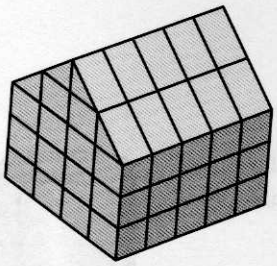

d)